Window Pane Problem-Solving Card

Station 1

Millie went on vacation for 4 weeks. If there are 7 days in one week, how many days was Millie on vacation?

Window Pane Problem-Solving Card

Station 2

Jim, Martin, and Clifton each purchased a set of 5 model cars. How many model cars did the 3 boys purchase in all?





Window Pane Problem-Solving Card

Station 3

Mrs. Milburn arranged the student desks in her classroom into 6 rows. There were 5 student desks in each row. How many student desks were in Mrs. Milburn's arrangement?

Window Pane Problem-Solving Card

Station 4

Judy has 3 fishbowls in her room. There are 11 fish in each fishbowl. How many fish does Judy have in her room in all?

Making Math Accessible to Students With Special Needs (3–5) © 2010 r4 Educated Solutions • solution-tree.com
Visit **go.solution-tree.com/specialneeds** to download this page.

Window Pane Problem-Solving Card

Station 5

Mr. Hakim placed math books in 4 stacks on a shelf. There were 9 math books in each stack. How many math books did Mr. Hakim place on the shelf?

Window Pane Problem-Solving Card

Station 6

Write your own problem using this story mat and Apple Counters.



Making Math Accessible to Students With Special Needs (3–5) © 2010 r4 Educated Solutions • solution-tree.com
Visit **go.solution-tree.com/specialneeds** to download this page.